GET MORE RESOURCES LIKE THIS ON ECOLEBOOKS.COM

LOHANA SCHOOLS

P.3 MATHS REVISION WORK: 2020

ACTIVITY THREE

1. What is a set?
2. Name these sets.

M

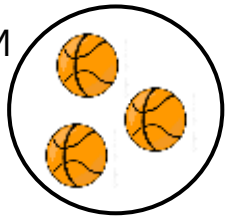

P



Q

3. Form small sets from the given big set.

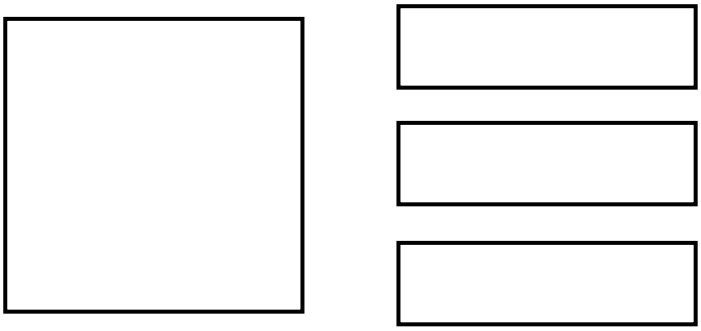

4. Write 4 examples of empty sets.
5. Subtract: $\frac{4}{7}$ - $\frac{3}{7}$
6. Which number comes in the middle of 9 and 11?
7. Draw an oval.
8. Write 523 in expanded form.
9. a) Tell the time.

b) Show the time on the clock face below;
It is a quarter past 10 o'clock

10. A farmer planted 61 maize plants in March and 48 in June. How many maize plants did he plant altogether?

GET MORE RESOURCES LIKE THIS ON ECOLEBOOKS.COM

GET MORE RESOURCES LIKE THIS ON ECOLEBOOKS.COM

11. Name these shapes.

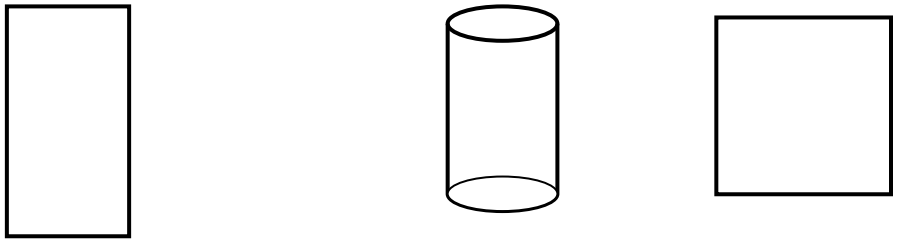

P.3 ENGLISH REVISION WORK ACTIVITY THREE:2020

Read the story and answer the questions about it in full sentences.

Mr. Musoke's farm

Mr. Musoke's farm is in Jinja. He keeps cows, goats and sheep. He works with his children on the farm. Mary looks after the goats. Francis grazes the cows and Jordan cares for the sheep. Every evening Mr. Musoke closes the farm gate.

Questions:

1. Where is Musoke's farm?
2. List down three animals Mr. Musoke keeps.
3. How many children does Mr. Musoke have?
4. Who grazes cows?
5. Write the title of the story.
6. When does Mr. Musoke close the farm's gate?
7. What does Mary do on the farm?
8. Who works with Mr. Musoke on the farm?

Fill in the blank spaces with 'a' or 'an' to complete the sentences.

9. A pilot flies _____ aeroplane.
10. She wants _____ glass of water.
11. We waited for _____ hour.
12. We use _____ umbrella when it is raining.
13. My uncle is _____ teacher.

GET MORE RESOURCES LIKE THIS ON ECOLEBOOKS.COM

GET MORE RESOURCES LIKE THIS ON ECOLEBOOKS.COM

Give the plural form of the underlined words.

14. They have many sheep.
15. That goat has a black kid.
16. An ostrich has a long neck.
17. We have planted a tree.
18. Who has eaten my mango?

P.3 LITERACY REVISION WORK ACTIVITY THREE: 2020

1. Name the instrument that is used to show direction of places on a map.
2. Which title is given to a person who heads an urban council?
3. In which urban council is our school found?
4. Why is a map different from a picture?
5. How are lakes and rivers useful to people in air urban council?
6. **Use the diagram below to answer the questions that follow**;

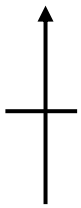

a) Name part marked P and T on a compass direction aside.

b) Apart from mountain climbers, outline any two groups of people who use a compass.

7. a) On which hill is our school found?

   b) How are hills or mountains useful to people? (Give two ways)

   c) State any one problem faced by people who settle around hills or mountains.

8. What are physical features?

GET MORE RESOURCES LIKE THIS ON ECOLEBOOKS.COM

GET MORE RESOURCES LIKE THIS ON ECOLEBOOKS.COM

9. How do we call the highest point of a mountain?
10. What is a hill?
11. Write any one example of a hill in our urban council.
12. On which hill do we find the Uganda Museum?
13. Name any one thing kept in a museum.
14. Draw the following map symbols.

Dam	Waterfall

b) Name any two examples of drainage physical features.

15. How are hills important to people in our urban council?
16. Which name is given to a water logged area with vegetation?
17. Give any one problem faced by people who settle around swampy areas.

P.3 RELIGIOUS EDUCATION REVISION WORK ACTIVITY THREE 2020

1. Either: Name the man of God who made the ark.

   Or: Which prophet died in the floods according to Islam?

2. Either: Whom did Moses talk to in the burning bush?

   Or: Identify any one prophet in Islam apart from Prophet Muhammad.

3. Either: Which is the Holy book for Christians?

   Or: Which is the most respected book in Islam?

4. Either: How many days do Christians fast during lent?

   Or: How many days do Moslems fast during Ramadhan?

5. Both: a) What are beliefs?

   b) State any four beliefs people have in our community.

GET MORE RESOURCES LIKE THIS ON ECOLEBOOKS.COM

GET MORE RESOURCES LIKE THIS ON ECOLEBOOKS.COM

6. Both: Who was the first man to be created by God?
7. Either: Who was the promised son of Abraham?
   Or: Who was the son of Prophet Ibrahim?
8. Both: How do you greet in your tribe?
9. Both: Write two reasons why you greet people.
10. Either: Give two reasons why we practice Christian customs.
    Or: Give two reasons why we practice Muslim customs.
11. Either: Who was the greatest and last prophet in Christianity?
    Or: Who was the last prophet in Islam?
12. Both: Why do people pay bride price?
    Both: Draw and name any two materials paid as bride price.

GET MORE RESOURCES LIKE THIS ON ECOLEBOOKS.COM